Name _____

Reading Spring Scales (Newtons)

Read each spring scale and write the correct mass in Newtons.

_____

_____

_____



_____



_____



_____

© 15Worksheets.com