Name _____

ADDITION ON NUMBER LINE

Using the number lines, complete the addition sentence and find the answer.

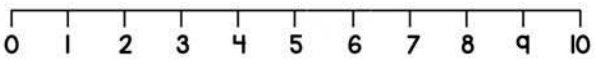

4 + ☐ = 7

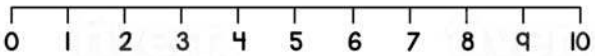

3 + ☐ = 5

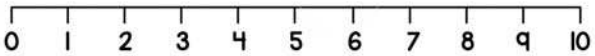

2 + ☐ = 9

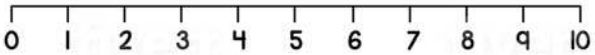

5 + ☐ = 8

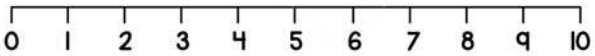

7 + ☐ = 10

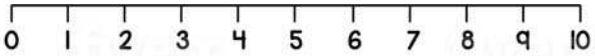

4 + ☐ = 10

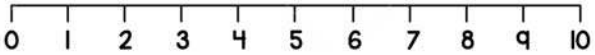

8 + ☐ = 10

© 15Worksheets.com